Chem 109A
Prof. Bode
Fall 2005, MWF 11-12

Name_____

Perm No._____

Quiz 3 (33 points)

1. Draw the products of the following reactions.(21 points)

(a) 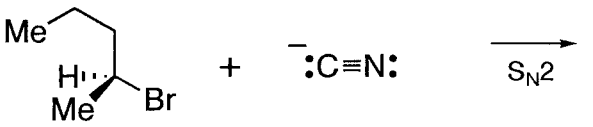

(b) 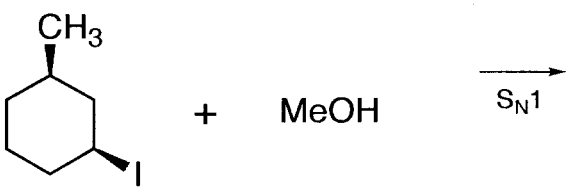

(c)

2. Identify the following reactions as either S_N1 or S_N2. (12 points)

(a) 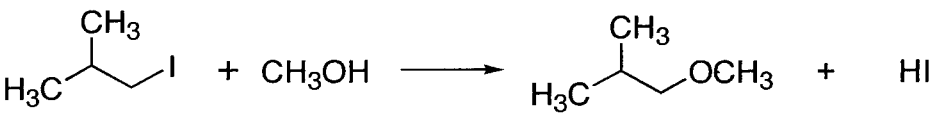

(b) 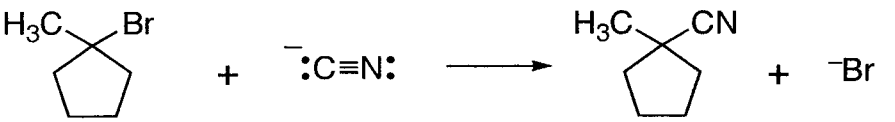

(c) 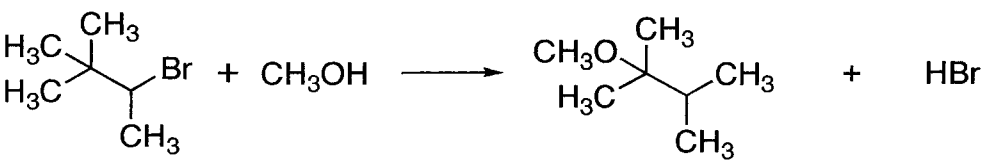
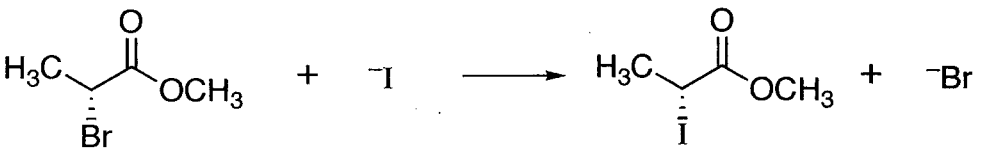
(d)